A

Question Booklet Sl. No.

Series
A

CODE : EEM – 1/25

Write here Roll Number and Answer Sheet No.

Roll No.

Answer Sheet No.

Duration : 3 Hours

Total Marks : 300

Declaration by Invigilator :
I Certify that I have checked that the Roll Number and the Answer Sheet Number written by the Candidate on the question paper and the OMR Sheet are correct and the Answer Sheet Number matches the Question Booklet Number exactly.

Signature of the Invigilator with Name

Declaration by Candidate :
I undertake not to employ any unfair means in this exam. I have checked the Question Booklet Number and the Answer Sheet Number and both are identical and have been correctly entered by me wherever indicated.

Signature of the Candidate with Name

Read the following instructions carefully before you begin to answer the questions.

IMPORTANT INSTRUCTIONS TO CANDIDATES

1. The Roll No. is a **7** digit No., the candidate needs to circle the Roll No. in the Answer Sheet.
2. The appropriate Circle should be shaded for Roll No. This should be done carefully because only the shaded circles are scanned.
3. Valuation of Answer Sheet will be done on the computer. Candidate should not make any stray marks on the Answer Sheet, tamper with or mutilate it. Otherwise it will not be evaluated.
4. Please check all the pages of the Booklet carefully. In case of any defect, please ask the Invigilator for replacement of the Booklet.
5. You must not tear off or remove any sheet from this Booklet. The Answer Sheet must be handed over to the Invigilator before you leave the Examination Hall.
6. All questions are compulsory and each Question carries **2** marks.
7. **There will be a negative marking of ¼ for incorrect answer (i.e. ¼ of 2 = 0.5).**
8. This Booklet contains **150** questions. Candidates must note that there will be 3 Sections in the question paper :

Sections	Test Components	No. of Questions	Page No.
A	General English	1-50	5 – 10
B	Elementary Math	51-100	11 – 17
C	General Knowledge	101-150	18 – 23

9. Use of Calculator/Palmtop/Laptop/Other Digital Instrument/Mobile/Cell Phone/Pager is **not** allowed.
10. Candidates found guilty of misconduct/using unfair means in the Examination Hall will be liable for appropriate penal/legal action.
11. **No Rough Work is to be done on the Answer Sheet and only single OMR Answer Sheet will be provided.**
12. This booklet contains **24** pages.
13. **Directions** : Each question or incomplete statement is followed by four alternative suggested answers or completions. In each case, you are required to select the one that correctly answers the question or completes the statement and blacken (●) appropriate circle a, b, c or d by Black Ball-Point Pen provided by the Board against the question concerned in the Answer Sheet.
14. Mark your answer by shading the appropriate circle against each question. The circle should be shaded completely without leaving any space. The correct method of shading is given below.

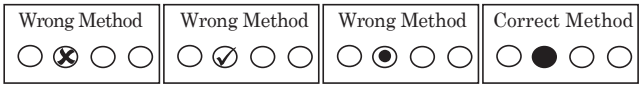

The Candidate must mark his/her response after careful consideration, as it is not possible to change the response once it is marked.

15. There is only one correct answer to each question. You should blacken (●) the circle of the appropriate column, viz., a, b, c or d. If you blacken (●) more than one circle against any one question, the answer will be treated as wrong.
16. Use the space for rough work given at the beginning of the Question Booklet only and not on the Answer Sheet.
17. **You are NOT required to mark your answers in this Booklet. All answers must be indicated in the Answer Sheet only.**

A

DO NOT WRITE HERE

SPACE FOR ROUGH WORK

SPACE FOR ROUGH WORK

SECTION – A
(General English)

Direction (Q. No. 1 – 10) : Fill in the blanks with appropriate phrasal verb.

1. How long _____before Val finally turned up ?
   (a) have you been waiting (b) are you waiting
   (c) you waited (d) had you been waiting

2. You _____be so good at backgammon, did you ?
   (a) never used to (b) got used to
   (c) are used to (d) wouldn't

3. Could you tell me, sir, what you _____ in the park at three in the morning ?
   (a) have done (b) have been doing
   (c) had done (d) were doing

4. I was angry when you saw me because I _____ with my sister.
   (a) have been arguing (b) argued
   (c) would argue (d) had been arguing

5. The Black Pirate _____ over a million copies already this year.
   (a) had sold (b) has sold
   (c) had been selling (d) was selling

6. Don't throw the paper away because I _____ it yet.
   (a) haven't read (b) hadn't read
   (c) haven't been reading (d) hadn't been reading

7. By the time we arrived, the film _____ .
   (a) has already started (b) would already start
   (c) already started (d) had already started

8. We had to walk home in the end because Jimmy _____ his car keys.
   (a) has been losing (b) had lost
   (c) was losing (d) had been losing

9. It took Edward a long time to _____ living in Canada.
   (a) be used to (b) used to
   (c) be used (d) get used to

10. I'd love to have lived in the old days, when people _____ to market by horse and carriage.
    (a) have been travelling (b) would travel
    (c) got used to travelling (d) had been travelling

Direction (Q. No. 11 – 14) : Fill in the blanks with the correct preposition.

11. The lamp is _____ the table.
    (a) in (b) above
    (c) under (d) on

12. The book is _____ the mug and the pen.
    (a) in (b) between
    (c) on (d) above

13. There is a bench _____ my house.
    (a) under (b) on
    (c) above (d) in front of

14. There are apple trees _____ the house.
    (a) behind (b) in
    (c) on (d) at

Direction (Q. No. 15 – 19) : Fill in the blanks with suitable active and passive verb forms.

15. We _____ for the examination.
    (a) have preparing (b) are preparing
    (c) had preparing (d) have been prepared

16. It _____ since yesterday.
    (a) is raining (b) has been raining
    (c) have been raining (d) was raining

17. I _____ for five hours.
    (a) have been working (b) has been working
    (c) was working (d) am working

18. The students _____ to submit their reports by the end of this week.
    (a) have asked (b) are asked
    (c) has asked (d) are asking

19. She _____ for a while.
(a) are ailing (b) is ailing
(c) have been ailing (d) has been ailing

20. Choose the sentence with correct structure.
(a) He going to school every day. (b) He goes to school every day.
(c) He go to school every day. (d) He gone to school every day.

21. Choose the correctly structured sentence.
(a) She can sings well. (b) She can sing well.
(c) She can singing well. (d) She can to sing well.

22. Identify the sentence that is grammatically correct.
(a) I have seen him yesterday. (b) I seen him yesterday.
(c) I had saw him yesterday. (d) I saw him yesterday.

23. Choose the correctly formed question.
(a) What you are doing ? (b) What are you doing ?
(c) What doing are you ? (d) You are doing what ?

24. Choose the correct sentence structure.
(a) My mother she cooks dinner. (b) My mother cooks dinner.
(c) My mother cooking dinner. (d) My mother cook dinner.

25. Choose the correct sentence.
(a) There is a dog in the yard. (b) There a dog is in the yard.
(c) A dog there is in the yard. (d) In the yard there is dog.

26. Choose the correctly structured passive sentence.
(a) The cake was baked by Mary. (b) Mary was baked the cake.
(c) The cake baked by Mary. (d) Mary bakes was the cake.

27. Identify the correct complex sentence.
(a) I was tired I took a nap. (b) I took a nap because I was tired.
(c) Because I was tired. I took a nap. (d) I took a nap. Because I was tired.

28. Choose the correct use of a compound sentence.
(a) I wanted to go, but it was raining. (b) I wanted to go but it was raining.
(c) I wanted, to go but it was raining. (d) I wanted to go. But it was raining.

29. Choose the correct form of a question tag.
(a) She is coming, isn't she ?
(b) She is coming, doesn't she ?
(c) She is coming, hasn't she ?
(d) She is coming, didn't she ?

Direction (Q. No. 30 – 40) : Choose appropriate synonym of the words from among the alternatives given below them :

30. Banish
(a) exile
(b) hate
(c) fade
(d) clean

31. Fraud
(a) malcontent
(b) argument
(c) clown
(d) imposter

32. Saccharine
(a) leave
(b) sweet
(c) arid
(d) quit

33. Drag
(a) sleepy
(b) crush
(c) proud
(d) pull

34. Jovial
(a) incredulous
(b) merry
(c) revolting
(d) dizzy

35. Indifferent
(a) neutral
(b) unkind
(c) precious
(d) mean

36. Simulate
(a) excite
(b) imitate
(c) trick
(d) apelike

37. Charisma
(a) ghost
(b) force
(c) courage
(d) charm

38. Apportion
(a) divide
(b) decide
(c) cut
(d) squabble

39. Generic
(a) general
(b) cheap
(c) fresh
(d) elderly

40. Abroad
(a) native
(b) countryside
(c) at home
(d) foreign

Direction (Q. No. 41 – 45) : Choose appropriate antonym of the words from among the alternatives given below them :

41. Spread
(a) express
(b) prohibit
(c) contain
(d) none of the above

42. Cheap
(a) descent
(b) dear
(c) repel
(d) loss

43. Levity
(a) magnify
(b) plain
(c) gravity
(d) ephemeral

44. Quack
(a) front
(b) rear
(c) expert
(d) despair

45. Synthesis
    (a) calm
    (b) scarcity
    (c) agnosis
    (d) analysis

Direction (Q. No. 46 – 50) : Give one word substitute for the following from the alternatives given below them :

46. A close companion who shares difficult work
    (a) Comrade
    (b) Colonnade
    (c) Chalet
    (d) Bourgeois

47. The quality of being a nobleperson by birth
    (a) Bastard
    (b) Blue blood
    (c) Cannibal
    (d) Canine

48. An instrument for measuring the air pressure
    (a) Consortium
    (b) Barometer
    (c) Thermometer
    (d) Palmistry

49. The feeling or ideas that are suggested by a word
    (a) Complexion
    (b) Connotation
    (c) Coldwar
    (d) Chiromancy

50. The home of a large fierce wild animal
    (a) Den
    (b) Dome
    (c) Dimple
    (d) None of these

SECTION – B

(Elementary Math)

51. If A's income is 50% less than that of B's, then B income is what per cent more than that of A ?

(a) 125% (b) 100% (c) 75% (d) 50%

52. $1 + \cfrac{1}{1 + \cfrac{1}{1 + \cfrac{1}{3}}} = ?$

(a) $1\frac{4}{7}$ (b) $2\frac{4}{7}$ (c) $3\frac{4}{7}$ (d) $4\frac{4}{7}$

53. $(5967 - 2437 - 1910) \div ? = 27$

(a) 60 (b) 50 (c) 65 (d) 45

54. $\cfrac{\frac{1}{3} \times 20 \div 4}{\frac{1}{4} \times 25 \div 5} = ?$

(a) $\frac{4}{3}$ (b) $\frac{7}{3}$ (c) $\frac{5}{3}$ (d) $\frac{10}{3}$

55. The owner of an electronics shop charges his customer 22% more than the cost price. If a customer paid Rs. 10,980 for a DVD player, then what was the cost price of the DVD player ?

(a) Rs. 8,000 (b) Rs. 8,800 (c) Rs. 9,000 (d) Rs. 9,200

56. Mohan bought a watch with 25% discount on the selling price. If the watch cost him Rs. 1,545, what is the original selling price of the watch ?

(a) Rs. 2,050 (b) Rs. 2,060
(c) Rs. 2,040 (d) Cannot be determined

57. $0.863 \times 0.637 + 0.863 \times 0.363 = ?$

(a) 0.863 (b) 1
(c) 8.63 (d) 1.226

58. The value of $\frac{(3.537-0.948)^2+(3.537+0.948)^2}{3.537\times3.537+0.948\times0.948}$ is

(a) 4.485 (b) 2.585 (c) 4 (d) 2

59. $\frac{(0.5)^4-(0.4)^4}{(0.5)^2+(0.4)^2}$ is equal to

(a) 0.09 (b) 0.9 (c) 9 (d) 0.009

60. A car travels a distance of 45 kms at the speed of 15 kmph. It covers the next 50 kms of its journey at the speed of 25 kmph and the last 25 kms of its journey at the speed of 10 kmph. What is the average speed of the car ?

(a) 16 kmph (b) 24 kmph (c) 15 kmph (d) 18 kmph

61. The ratio between the ages of Kamal and Savita is 6 : 5 and the sum of their ages is 44 years. The ratio of their ages after 8 years will be

(a) 5 : 6 (b) 7 : 8 (c) 8 : 7 (d) 14 : 13

62. A number exceeds its one-seventh by 84. The number is

(a) 12 (b) 14 (c) 98 (d) 196

63. If 10 be added to four times a certain number, the result is 5 less than 5 times the number. The number is

(a) 35 (b) 20 (c) 25 (d) 15

64. The next term of the sequence 3/2, 5/4, 9/8, 17/16, ... is

(a) 33/32 (b) 29/32 (c) 43/42 (d) 35/32

65. $\frac{(20^2-10^2)\div5\times3+10}{\frac{1}{3}\text{ of }27+10\div2+1}=?$

(a) $10\frac{2}{3}$ (b) $14\frac{1}{3}$ (c) 15 (d) $12\frac{2}{3}$

66. $1.\overline{6}$ expressed as a fraction is

(a) $\frac{16}{10}$ (b) $\frac{16}{09}$

(c) $\frac{5}{3}$ (d) None of these

67. Which part contains the fractions in ascending order ?

(a) $\frac{11}{14}, \frac{16}{19}, \frac{16}{21}$ (b) $\frac{16}{19}, \frac{11}{14}, \frac{16}{21}$ (c) $\frac{16}{21}, \frac{11}{14}, \frac{16}{19}$ (d) $\frac{16}{19}, \frac{16}{21}, \frac{11}{14}$

68. The greatest number, which when subtracted from 5834, gives a number exactly divisible by each of 20, 28, 32 and 35 is

(a) 4714 (b) 1120 (c) 5200 (d) 5600

69. The L.C.M. of $(x + 2)^2 (x – 2)$ and $(x^2 – 4x – 12)$ is

(a) $(x + 2) (x – 2)$ (b) $(x + 2) (x – 2) (x – 6)$

(c) $(x + 2) (x – 2)^2$ (d) $(x + 2)^2 (x – 2) (x – 6)$

70. The L.C.M. of $(x^2 – 1)$, $(x^2 + x)$ and $(x + 1)^2$ is

(a) $(x + 1)$ (b) $(x^2 – 1) (x + 1)^2$

(c) $(x^2 – 1) (x^2 + x)$ (d) $(x^2 – 1) (x + 1)$

71. The traffic lights at three different road crossings change after 24 seconds, 36 seconds and 54 seconds respectively. If they all change simultaneously at 10:15:00 AM, then at what time will they again change simultaneously ?

(a) 10:18:36 AM (b) 10:16:54 AM

(c) 10:17:02 AM (d) 10:22:12 AM

72. The H.C.F. of $(x^3 + x^2 + x + 1)$ and $(x^4 – 1)$ is

(a) $(x^2 – 1) (x^2 + 1)$ (b) $(x + 1) (x^2 – 1)$

(c) $(x + 1) (x^2 + 1)$ (d) $(x^2 + 1) (x + 1) (x^3 + 1)$

73. If $(x – 1)$ is the H.C.F. of $(x^2 – 1)$ and $px^2 – q(x + 1)$, then

(a) $p = 2q$ (b) $q = 2p$ (c) $3p = 2q$ (d) $2p = 3q$

74. The H.C.F. of $2(x^2 – y^2)$ and $5(x^3 – y^3)$ is

(a) $(x – y)$ (b) $2(x^2 – y^2)$

(c) $(x + y)$ (d) $10(x – y) (x + y) (x^2 + xy + y^2)$

75. Two numbers are in the ratio 3 : 5. If each is increased by 10, the ratio becomes 5 : 7. The numbers are

(a) 3, 5 (b) 12, 20 (c) 15, 25 (d) 30, 42

76. The ratio of third proportional to 12 and 30 and the mean proportional to 9 and 25 is

(a) 5 : 1 (b) 2 : 1 (c) 9 : 14 (d) 7 : 15

77. The sides of a triangle are in the ratio $\frac{1}{2}:\frac{1}{3}:\frac{1}{4}$ and its perimeter is 104 cm. The length of the longest side is

(a) 48 cm (b) 52 cm (c) 32 cm (d) 26 cm

78. The salaries of A, B, C are in the ratio 2 : 3 : 5. If the increments of 15%, 10% and 20% are allowed respectively in their salaries, then what will be the new ratio of their salaries ?

(a) 3 : 3 : 10 (b) 10 : 11 : 20

(c) 23 : 33 : 60 (d) Cannot be determined

79. The population of a town is 126800. It increases by 15% in the 1st year and decreases by 20% in the 2nd year. What is the population of the town at the end of 2 years ?

(a) 174984 (b) 135996 (c) 116656 (d) 145820

80. A student scores 64% marks in 6 papers of 150 marks each. He scores 25% of his total obtained marks in Hindi and English together. How much is his total score for both these papers ?

(a) 120 (b) 124 (c) 140 (d) 144

81. The average of five numbers is 281. The average of the first two numbers is 280 and the average of the last two numbers is 178.5. What is the third number ?

(a) 488 (b) 336 (c) 228 (d) 464

82. In a family, the average age of a father and a mother is 35 years. The average age of the father, mother and their only son is 27 years. What is the age of the son ?

(a) 12 years (b) 11 years (c) 15 years (d) 10 years

83. Average of first five prime numbers is

(a) 3.6 (b) 5.3 (c) 5.6 (d) 5

84. Cost price of 100 books is equal to the selling price of 60 books. The gain percentage will be

(a) $66\frac{2}{3}\%$ (b) $66\frac{1}{4}\%$ (c) 66% (d) $66\frac{3}{4}\%$

85. By selling an article for Rs. 450. I lose 20%. For what amount should I sell it to gain 20% ?

(a) Rs. 490 (b) Rs. 470 (c) Rs. 562.50 (d) Rs. 675

86. What profit/loss percent did Ravi earn if he purchased an item of Rs. 5,600 and sold it at three-fourth of its cost price ?

(a) Loss of 20 percent (b) Gain of 25 percent

(c) Neither gain nor loss (d) Loss of 25 percent

87. 10% discount and then 20% discount in succession is equivalent to total discount of

(a) 15% (b) 30% (c) 24% (d) 28%

88. A manufacturer marked an article at Rs. 50 and sold it allowing 20% discount. If his profit was 25% then the cost price of the article was

(a) Rs. 40 (b) Rs. 35 (c) Rs. 32 (d) Rs. 30

89. If the diameter of a cylinder is 28 cm and its height is 20 cm, then total surface area (in cm^2) is

(a) 2993 (b) 2992 (c) 2292 (d) 2229

90. A solid metal ball of radius 8 cm is melted and cast into smaller balls, each of radius 2 cm. The number of such ball is

(a) 8 (b) 16 (c) 32 (d) 64

91. If the surface area of a sphere is 144π sq. m, then its volume (in cu.m) is

(a) 288π (b) 316π

(c) 300π (d) 188π

92. Two circular cylinders of equal volume have their heights in the ratio 1 : 2. Ratio of their radii is

(a) 1 : 4 (b) $\sqrt{2}:1$

(c) 1 : 2 (d) None of these

93. 120 men had food for 200 days. After 5 days, 30 men died due to COVID. The remaining food will now last for

(a) 150 days (b) $146\frac{1}{4}$ days (c) 245 days (d) 260 days

94. If 3 persons weave 168 shawls in 14 days, how many shawls will 8 persons weave in 5 days ?

(a) 90 (b) 105 (c) 126 (d) 160

95. A can complete 1/3 of a work in 5 days and B, 2/5 of the work in 10 days. In how many days both A and B together can complete the work ?

(a) 10 days (b) $9\frac{3}{8}$ days (c) $8\frac{4}{5}$ days (d) $7\frac{1}{2}$ days

96. 7 men can complete a piece of work in 12 days. How many additional men will be required to complete double the work in 8 days ?

(a) 28 (b) 21 (c) 14 (d) 7

97. A train 270 meter long is running at a speed of 36 km per hour, then it will cross a bridge of length 180 meters is

(a) 40 sec (b) 45 sec (c) 50 sec (d) 35 sec

98. Study the following bar graph and answer the question that follows :

Total monthly income = Rs. 50,000.

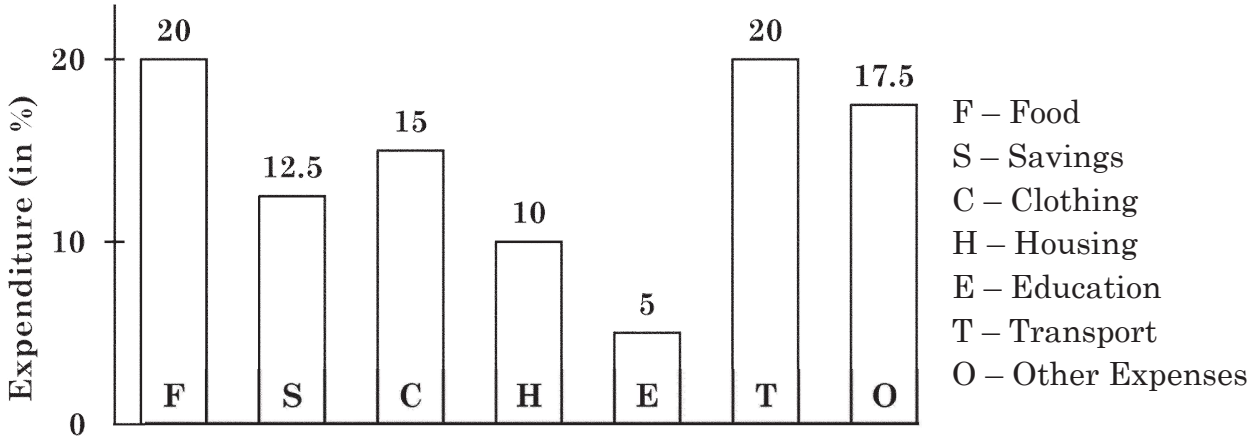

What amount is spent on food ?

(a) Rs. 1,000 (b) Rs. 2,500

(c) Rs. 10,000 (d) Rs. 12,000

99. Study the pie chart below and answer the question that follows :

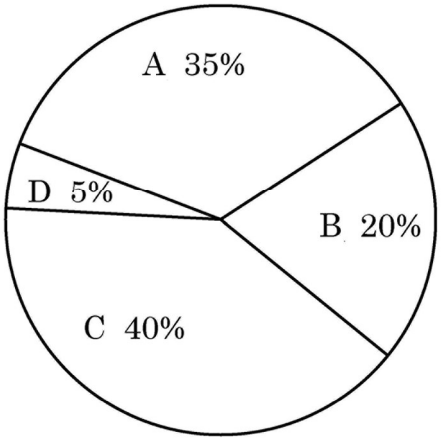

The above pie chart shows the sales of four different types of articles in a shop. If the total sale is 1200, what is the sale of B ?

(a) 120 (b) 240

(c) 360 (d) None of these

100. The following table contains the data on train arrival and train departure from a station. Study the table and answer the question that follows :

Delay	No. of Arrivals	No. of Departures
0	1250	1400
0 – 30	114	82
30 – 60	31	5
> 60	5	3
Total	**1400**	**1490**

The percentage of late-arriving trains is

(a) 10% (b) 10.51%

(c) 10.71% (d) None of these

SECTION – C
(General Knowledge)

101. The Indological perspective claims to understand Indian society through
(a) Field surveys and reports
(b) Political debates
(c) Concepts, theories and frameworks
(d) None of these

102. Who translated Manusmriti into English ?
(a) William Jones (b) Max Weber
(c) Herbert Risley (d) None of these

103. According to Ghurye, the sociology of India is not ____ it emanates from ancient India, through medieval India and reaches modern India.
(a) dynamic (b) traditional
(c) static (d) modern

104. Iran refers to which group as the "Zionist regime" ?
(a) Hamas (b) Israel
(c) United States (d) Saudi Arabia

105. What is considered essential by Marxists for holding society together ?
(a) Religious unity (b) Bonds of kinship
(c) Language and tradition (d) Bonds of production

106. The Melghat Tiger Reserve is located in the State of
(a) Madhya Pradesh (b) Maharashtra
(c) Assam (d) Telangana

107. In 2014 The 18th SAARC Summit was held in which city ?
(a) New Delhi, India (b) Dhaka, Bangladesh
(c) Kathmandu, Nepal (d) Islamabad, Pakistan

108. G. S. Ghurye is often referred to as
(a) Father of Marxist Sociology (b) Father of Indian Anthropology
(c) Father of Indian Sociology (d) Father of Sanskrit Studies

109. Which organization released the first advance estimates of India's Gross Domestic Product (GDP) for 2024-25 ?
(a) Reserve Bank of India (RBI)
(b) NITI Aayog
(c) Ministry of Finance
(d) National Statistics Office (NSO)

110. In the Union Budget 2025 – 2026, the Foreign Direct Investment (FDI) limit was increased from 74% to 100% in which of the following Sector ?
(a) Insurance
(b) Banking
(c) Telecommunications
(d) Retail

111. In which of the following date was the Lokpal of India celebrated its inaugural Foundation Day in 2025 ?
(a) January 11
(b) January 1
(c) January 16
(d) January 26

112. What does the acronym EPFO stands for ?
(a) Employees' Provident Fund Organisation
(b) Employees' Pension Fund Organisation
(c) Employers' Provident Fund Organisation
(d) Employees' Public Finance Organisation

113. The inaugural International Conference on Carbon Markets, Prakriti 2025 was held on February 24 – 25 in which Indian city ?
(a) New Delhi
(b) Mumbai
(c) Hyderabad
(d) None of these

114. What was the name of the satellite launched during ISRO's 100th mission from Sriharikota on January 29, 2025 ?
(a) NVS-01
(b) GSAT-24
(c) NVS-02
(d) INSAT-3D

115. ISRO and IIT Madras have jointly developed which indigenous microprocessor for space applications ?
(a) SHAKTI
(b) SANGAM
(c) VEDA
(d) IRIS

116. The 2025 peace agreement between Armenia and Azerbaijan seeks to end conflict over which region ?
(a) Crimea
(b) Kashmir
(c) Golan Heights
(d) Nagorno-Karabakh

117. Who established the Sunga Dynasty ?
(a) Pushyamitra Sunga (b) Devamitra Sunga
(c) Bhadrasena Sunga (d) Agnimitra Sunga

118. Simuka was the founder of which Indian dynasty ?
(a) Nanda Dynasty (b) Maurya Dynasty
(c) Gupta Dynasty (d) Satavahana Dynasty

119. What was the capital of the Chola Empire ?
(a) Tanjore (b) Madurai
(c) Kanchipuram (d) Uraiyur

120. Which of the following cities did Alauddin Khilji first conquer ?
(a) Gujarat (b) Delhi
(c) Malwa (d) Chittor

121. The foundation of the Mughal rule in India was laid by Babur in which year ?
(a) 1524 AD (b) 1525 AD
(c) 1526 AD (d) 1530 AD

122. Who acted as regent when Akbar ascended the throne ?
(a) Man Singh (b) Hemu
(c) Bairam Khan (d) Abul Fazl

123. Which is the only monument associated with Aurangzeb ?
(a) Moti Masjid (b) Bibi ka Maqbara
(c) Badshahi Mosque (d) Buland Darwaza

124. Who was called the "Lion of Punjab" ?
(a) Duleep Singh (b) Bhagat Singh
(c) Lala Lajpat Rai (d) Subhas Chandra Bose

125. Which of the following titles was returned by Mahatma Gandhi as a protest against the Jallianwala Bagh massacre in 1919 ?
(a) Bharat Ratna (b) Companion of the Indian Empire
(c) Order of British India (d) Kaiser-i-Hind

126. According to the National Calendar based on Saka Era, which of the following is the first month ?
(a) Magha (b) Vaisakha
(c) Chaitra (d) None of these

127. When did India conduct its first nuclear explosion test ?
(a) May 1948 (b) May 1962
(c) May 1965 (d) May 1974

128. Who was the Prime Minister of India when the Tashkent Agreement was signed ?
(a) Jawaharlal Nehru (b) Lal Bahadur Shastri
(c) Indira Gandhi (d) Morarji Desai

129. Who was the Prime Minister of China when the Panchsheel Agreement was signed ?
(a) Mao Zedong (b) Xi Jinping
(c) Deng Xiaoping (d) Chou En-Lai

130. When is Human Rights Day observed ?
(a) 26th January (b) 24th October
(c) 10th December (d) 5th June

131. In which year was the National Institution for Transforming India (NITI Aayog) established ?
(a) 2012 (b) 2013
(c) 2014 (d) 2015

132. Which Article of the Indian Constitution provides that the Goa Legislative Assembly shall consist of not less than 30 members ?
(a) Article 370 (b) Article 371-I
(c) Article 239-A (d) None of these

133. The provision of the Tenth Schedule pertaining to exemption from disqualification in case of split by one-third members of legislature party has been deleted by which Amendment Act ?
(a) 52nd Amendment Act 1972 (b) 86th Amendment Act 1988
(c) 91st Amendment Act of 2003 (d) 101st Amendment Act 2008

134. Which of the following Article of the Constitution provides that the Election Commission of India has power to, direct and control elections to Parliament, Legislatures, President and Vice-President ?
(a) Article 320 (b) Article 324
(c) Article 326 (d) Article 312

135. The Constitutional provisions related to the Eighth Schedule of the Indian Constitution are mentioned in

(a) Articles 343 and 350
(b) Articles 344(1) and 351
(c) Articles 350A and 351
(d) Articles 346 and 352

136. Under which of the following lists of the Indian Constitution does "Public Health and Sanitation" fall ?

(a) Union List
(b) State List
(c) Concurrent List
(d) Residuary List

137. When did the Sanskrit and Maithili translations of the Indian Constitution unveiled ?

(a) November 25, 2024
(b) November 28, 2024
(c) November 27, 2024
(d) November 26, 2024

138. Which Part of the Indian Constitution contains provisions related to the organisation, powers, jurisdiction, independence and procedures of the High Courts ?

(a) Part IV
(b) Part V
(c) Part VI
(d) Part IX

139. What is the quorum required for a meeting of the Rajya Sabha ?

(a) 1/2 of the total members
(b) 1/3 of the total members
(c) 1/5 of the total members
(d) 1/10 of the total members

140. Who became the acting President of India after the death of Dr. Zakir Hussain in 1969 ?

(a) Mohammad Hidayatullah
(b) V. V. Giri
(c) Neelam Sanjiva Reddy
(d) Fakhruddin Ali Ahmed

141. When was the First Finance Commission established in India ?

(a) 1953
(b) 1950
(c) 1951
(d) 1954

142. Which of the following ruler of Manipur Estate signed an agreement prior to independence with the Government of India to become a part of Indian Union ?

(a) Hari Singh
(b) Bodhchandra Singh
(c) Bir Tikendrajit Singh
(d) Gambhir Singh

143. Mohiniyattam, a dance belongs to which of the following State ?
(a) Tamil Nadu
(b) Kerala
(c) Andhra Pradesh
(d) Telangana

144. Tamasha is a traditional folk theatre form of which Indian State ?
(a) Uttar Pradesh
(b) Maharashtra
(c) Punjab
(d) Gujarat

145. The Gulaab Festival is celebrated in which of the following Indian States or Union Territories ?
(a) Rajasthan
(b) Andaman Nicobar
(c) Chandigarh
(d) Uttar Pradesh

146. Who won the 17th edition of the Indian Premier League (IPL) in 2024 ?
(a) Chennai Super Kings
(b) Royal Challengers Bengaluru
(c) Kolkata Knight Riders
(d) Sunrisers Hyderabad

147. In which year did both the Men's and Women's T20 World Cup titles go to the West Indies ?
(a) 2010
(b) 2012
(c) 2014
(d) 2016

148. Where were the 17th Paralympics 2024 held ?
(a) Tokyo (Japan)
(b) Beijing (China)
(c) Paris (France)
(d) London (UK)

149. Where were the World Military Wrestling Championships held in 2024 ?
(a) Moscow, Russia
(b) Yerevan, Armenia
(c) Tehran, Iran
(d) Baku, Azerbaijan

150. Ayhika and Sutirtha Mukherjee created history at the Asian Table Tennis Championships 2024 by winning which medal ?
(a) Gold
(b) Silver
(c) Bronze
(d) None of these

Arunachal Pradesh Staff Selection Board
Itanagar

Answer Key for EEM-1/25 (Set - A)

Question No.	Ans. Key	Question No.	Ans. Key	Question No.	Ans. Key
1	d	51	b	101	c
2	a	52	a	102	a
3	d	53	a	103	c
4	d	54	a	104	b
5	b	55	c	105	d
6	a	56	b	106	b
7	d	57	a	107	c
8	b	58	d	108	c
9	d	59	a	109	d
10	b	60	a	110	a
11	d	61	c	111	c
12	b	62	c	112	a
13	d	63	d	113	a
14	a	64	a	114	c
15	b	65	d	115	d
16	b	66	c	116	d
17	a	67	c	117	a
18	b	68	a	118	d
19	d	69	d	119	a
20	b	70	c	120	a
21	b	71	a	121	c
22	d	72	c	122	c
23	b	73	a	123	*
24	b	74	a	124	c
25	a	75	c	125	d
26	a	76	a	126	c
27	b	77	a	127	d
28	a	78	c	128	b
29	a	79	c	129	d
30	a	80	d	130	c
31	d	81	a	131	d
32	b	82	b	132	b
33	d	83	c	133	c
34	b	84	a	134	b
35	a	85	d	135	b
36	b	86	d	136	b
37	d	87	d	137	d
38	a	88	c	138	c
39	a	89	b	139	d
40	d	90	d	140	b
41	c	91	a	141	c
42	b	92	b	142	b
43	c	93	d	143	b
44	c	94	d	144	b
45	d	95	b	145	c
46	a	96	c	146	c
47	b	97	b	147	d
48	b	98	c	148	c
49	b	99	b	149	b
50	a	100	c	150	c

* Grace marks to all candidates

Arunachal Pradesh Staff Selection Board
Itanagar

Answer Key for EEM-1/25 (Set - B)

Question No.	Ans. Key	Question No.	Ans. Key	Question No.	Ans. Key
1	a	51	a	101	d
2	b	52	a	102	a
3	b	53	c	103	d
4	b	54	c	104	a
5	a	55	d	105	a
6	b	56	b	106	c
7	b	57	a	107	b
8	a	58	a	108	b
9	b	59	a	109	b
10	d	60	c	110	c
11	a	61	a	111	c
12	a	62	b	112	d
13	d	63	c	113	b
14	b	64	a	114	d
15	a	65	d	115	c
16	b	66	b	116	c
17	d	67	a	117	a
18	a	68	d	118	a
19	d	69	a	119	c
20	b	70	a	120	d
21	d	71	d	121	b
22	a	72	d	122	d
23	d	73	c	123	c
24	b	74	b	124	d
25	d	75	d	125	b
26	b	76	c	126	b
27	d	77	c	127	c
28	a	78	d	128	c
29	d	79	a	129	d
30	d	80	d	130	a
31	b	81	a	131	c
32	c	82	b	132	d
33	b	83	d	133	c
34	c	84	d	134	b
35	c	85	b	135	c
36	d	86	c	136	c
37	d	87	c	137	a
38	b	88	a	138	c
39	d	89	d	139	b
40	a	90	c	140	d
41	a	91	c	141	d
42	a	92	b	142	b
43	b	93	c	143	c
44	a	94	b	144	b
45	a	95	c	145	b
46	b	96	a	146	c
47	b	97	c	147	c
48	d	98	a	148	*
49	b	99	a	149	c
50	b	100	c	150	d

* Grace marks to all candidates

Arunachal Pradesh Staff Selection Board
Itanagar

Answer Key for EEM-1/25 (Set - C)

Question No.	Ans. Key	Question No.	Ans. Key	Question No.	Ans. Key
1	a	51	c	101	d
2	a	52	c	102	b
3	b	53	d	103	c
4	a	54	a	104	b
5	a	55	d	105	b
6	b	56	d	106	c
7	b	57	d	107	a
8	d	58	c	108	a
9	b	59	b	109	c
10	b	60	d	110	d
11	c	61	c	111	c
12	b	62	b	112	b
13	c	63	c	113	b
14	c	64	b	114	b
15	d	65	c	115	c
16	a	66	a	116	c
17	a	67	c	117	d
18	d	68	a	118	b
19	b	69	a	119	d
20	a	70	c	120	c
21	b	71	b	121	c
22	d	72	a	122	a
23	a	73	a	123	c
24	d	74	a	124	b
25	b	75	c	125	d
26	d	76	a	126	c
27	a	77	b	127	c
28	b	78	d	128	*
29	b	79	d	129	c
30	b	80	b	130	d
31	a	81	c	131	b
32	b	82	c	132	c
33	b	83	a	133	c
34	a	84	d	134	d
35	b	85	c	135	a
36	d	86	a	136	c
37	a	87	a	137	d
38	d	88	c	138	c
39	b	89	c	139	b
40	d	90	d	140	c
41	b	91	b	141	d
42	d	92	a	142	a
43	a	93	d	143	d
44	d	94	a	144	a
45	d	95	a	145	a
46	b	96	a	146	b
47	d	97	b	147	d
48	b	98	c	148	c
49	d	99	a	149	d
50	a	100	d	150	b

* Grace marks to all candidates

Arunachal Pradesh Staff Selection Board
Itanagar

Answer Key for EEM-1/25 (Set - D)

Question No.	Ans. Key	Question No.	Ans. Key	Question No.	Ans. Key
1	c	51	c	101	c
2	b	52	b	102	d
3	c	53	c	103	c
4	c	54	b	104	b
5	d	55	c	105	c
6	d	56	a	106	c
7	b	57	a	107	c
8	d	58	c	108	*
9	a	59	c	109	c
10	a	60	d	110	d
11	d	61	c	111	d
12	b	62	c	112	b
13	d	63	a	113	c
14	b	64	d	114	b
15	d	65	c	115	b
16	a	66	a	116	b
17	d	67	b	117	c
18	d	68	c	118	c
19	b	69	a	119	d
20	a	70	d	120	a
21	a	71	a	121	d
22	b	72	b	122	a
23	a	73	d	123	d
24	a	74	d	124	a
25	b	75	b	125	a
26	b	76	b	126	b
27	d	77	a	127	d
28	b	78	d	128	c
29	b	79	a	129	d
30	a	80	a	130	b
31	b	81	a	131	c
32	b	82	c	132	d
33	b	83	a	133	b
34	a	84	a	134	d
35	b	85	c	135	c
36	b	86	b	136	c
37	a	87	a	137	b
38	b	88	a	138	b
39	d	89	a	139	b
40	a	90	c	140	c
41	a	91	d	141	c
42	d	92	d	142	a
43	b	93	c	143	c
44	a	94	b	144	b
45	b	95	d	145	d
46	d	96	c	146	c
47	a	97	c	147	a
48	d	98	d	148	a
49	b	99	a	149	c
50	d	100	d	150	d

* Grace marks to all candidates